Lesson 1 Decimals Tens and Hundreds

Name _____

Directions:
Darken in the spaces depending on the numbers appearing below each question. The QR Code and button will provide directions and answers.

CLICK HERE FOR WINDOWS VIDEO

1



Units	decimal	Tenths	Hundreds	Thousandths
0	•	3		

2



Units	decimal	Tenths	Hundreds	Thousandths
	•	0	3	

3

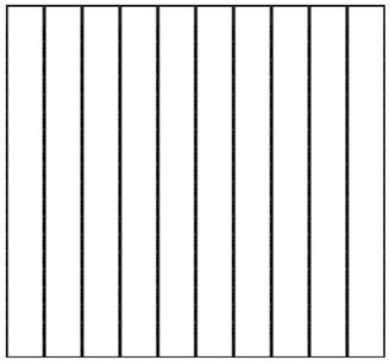

Units	decimal	Tenths	Hundreds	Thousandths
0	•	7		

4

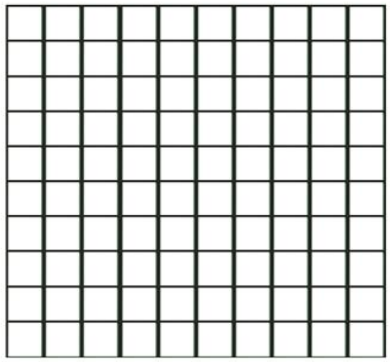

Units	decimal	Tenths	Hundreds	Thousandths
	•	0	7	

5



Units	decimal	Tenths	Hundreds	Thousandths
0	•	3		

6



Units	decimal	Tenths	Hundreds	Thousandths
	•	3	7	

7

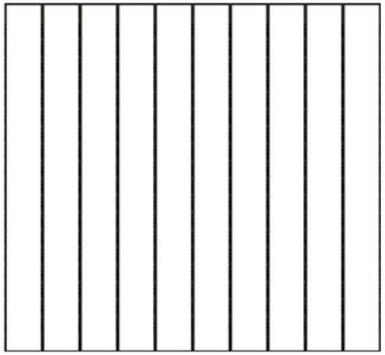

Units	decimal	Tenths	Hundreds	Thousandths
0	•	1		

8

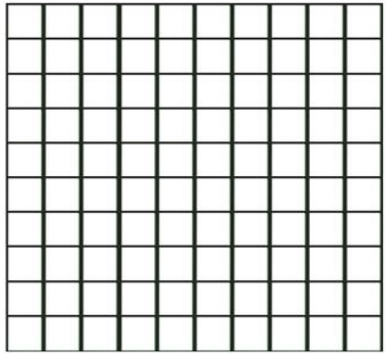

Units	decimal	Tenths	Hundreds	Thousandths
	•	1	5	