Worksheet for 2nd Grade Math Exit Lessons Video-1 Name _____

Darken in the correct answer below for A and B prob. 1

A

Tom was able to run 100 yards in 12 Seconds. Jim ran 88 yards in the same time. How much farther did Tom Run?

- 10 yards
- 22 yards
- 12 Yards
- 14 yards

B

A camping tent is 4 yards long. How many feet is it?

- 12 feet
- 10 feet
- 16 feet
- 8 feet

Look at the shapes below. Mark the shape that is the same. Problem 2

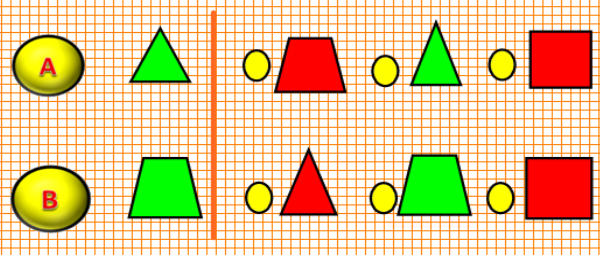

Prob 3

A

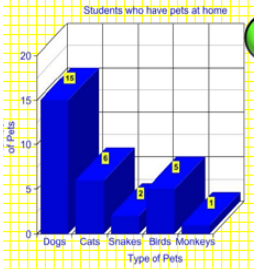

How many more students have dogs than cats?

- 8
- 7
- 9
- 13

Darken in the correct answer

B

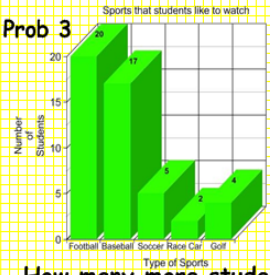

How many more students do you need who like Golf to be equal to baseball?

- 12
- 3
- 13
- 15

Darken in the correct answer

What time is shown on each Clock? Circle the correct answer below Prob. 4

A

- Quarter past 4
- Quarter till 4
- Quarter past 3
- Quarter till 5

B

- Quarter past 8
- Quarter till 9
- Quarter past 9
- Quarter past 8