Video 3 Equal Shares

Different Shapes Worksheet

Name _____ **QR Code Video**

Problem 1 Pick a pen and divide the squares below into 3 equal shares

A



B



Problem 2 Draw lines to show one way to divide the rectangle into 4 equal shares.

A



Draw lines to show a different way to divide the rectangle into 4 equal shares.

B

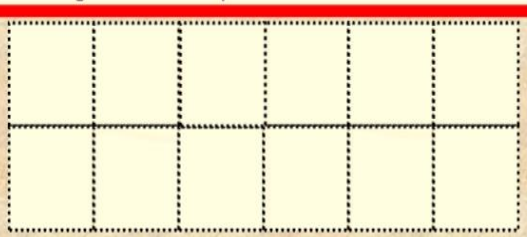

Problem 3 Draw lines to show two different ways to divide the rectangle into 2 equal shares.

A

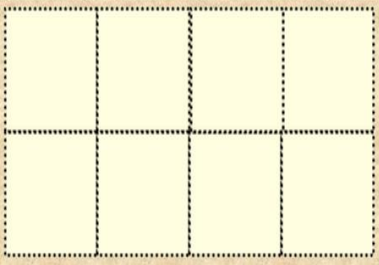

B

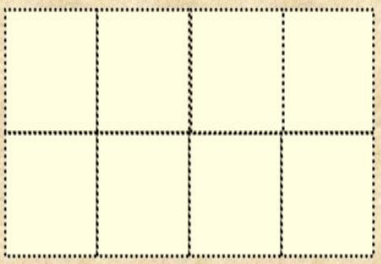

Problem 4 Pick a pen and divide the rectangles below into 3 equal shares

A

B



C