Video 1 Addition Dominos

Worksheet Name _____

Add the numbers and dominos below to get the total Lesson 1

0 1 2 3 4 5 6 7 8 9 10

11 12 13 14 15 16 17 18 19 20

21 22 23 24 25 26 27 28 29 30

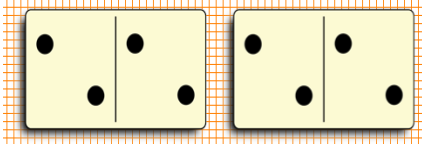

2 + 2 2 + 2 = ___

Add the numbers and dominos below to get the total Lesson 2

0 1 2 3 4 5 6 7 8 9 10

11 12 13 14 15 16 17 18 19 20

21 22 23 24 25 26 27 28 29 30

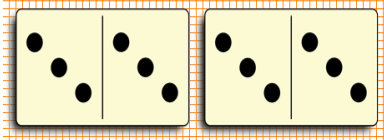

3 + 3 3 + 3 = ___

Add the numbers and dominos below to get the total Lesson 3

0 1 2 3 4 5 6 7 8 9 10

11 12 13 14 15 16 17 18 19 20

21 22 23 24 25 26 27 28 29 30

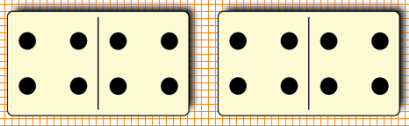

4 + 4 4 + 4 = ____

Add the numbers and dominos below to get the total Lesson 4

0 1 2 3 4 5 6 7 8 9 10

11 12 13 14 15 16 17 18 19 20

21 22 23 24 25 26 27 28 29 30



5 + 5 5 + 5 = ____