Video 2 Addition Dominos

Worksheet Name _____

Add the numbers and dominos below to get the total Lesson 1

0 1 2 3 4 5 6 7 8 9 10

11 12 13 14 15 16 17 18 19 20

21 22 23 24 25 26 27 28 29 30

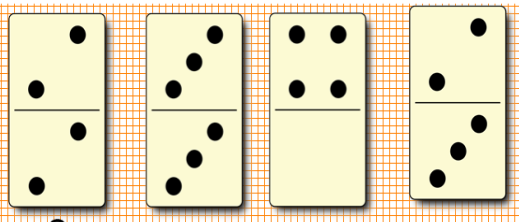

2	3	4	2
+ 2	+ 3	+ 0	+ 3

Add the numbers and dominos below to get the total Lesson 2

0 1 2 3 4 5 6 7 8 9 10

11 12 13 14 15 16 17 18 19 20

21 22 23 24 25 26 27 28 29 30

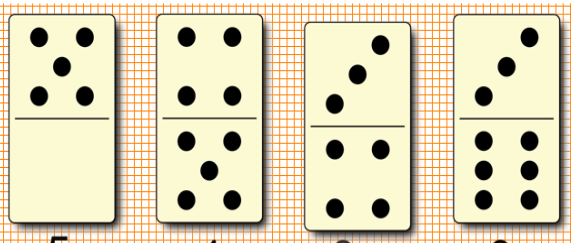

5	4	3	3
+ 0	+ 5	+ 4	+ 6

Add the numbers and dominos below to get the total Lesson 3

0 1 2 3 4 5 6 7 8 9 10

11 12 13 14 15 16 17 18 19 20

21 22 23 24 25 26 27 28 29 30

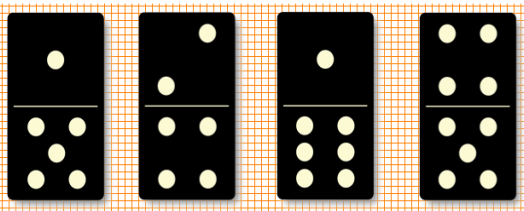

1	2	1	4
+ 5	+ 4	+ 6	+ 5

Add the numbers and dominos below to get the total Lesson 4

0 1 2 3 4 5 6 7 8 9 10

11 12 13 14 15 16 17 18 19 20

21 22 23 24 25 26 27 28 29 30

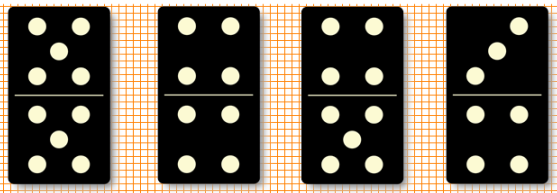

5	4	4	3
+ 5	+ 4	+ 5	+ 4