NAME _____ DECIMALS LESSON 3

What decimal number is illustrated?



- 0.5
- 0.4
- 0.3
- 0.6

What decimal number is illustrated?



- 0.62
- 0.63
- 0.26
- 0.50

What decimal number is illustrated?



- 0.40
- 0.38
- 0.37
- 0.58

What decimal number is illustrated?



- 0.52
- 0.35
- 0.53
- 0.42

What decimal number is illustrated?

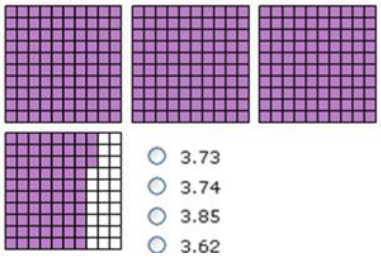

- 3.73
- 3.74
- 3.85
- 3.62

Lesson 1

What decimal number is illustrated?



- 1.74
- 1.48
- 1.84
- 1.73

What decimal number is illustrated?

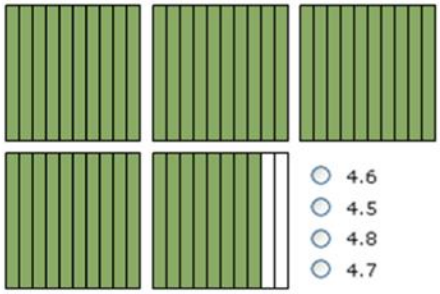

- 4.6
- 4.5
- 4.8
- 4.7

What decimal number is illustrated?

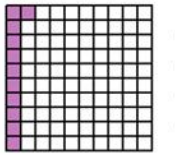

- 0.12
- 0.11
- 0.21
- 0.32

Lesson 2

What decimal number is illustrated?



- 0.3
- 0.2
- 0.5
- 0.4

What decimal number is illustrated?



- .04
- .4
- 4
- .004

What decimal number is illustrated?

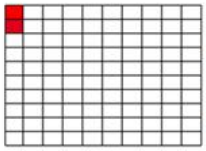

- .2
- .02
- .20
- .002

What decimal number is illustrated?



- .26
- .2
- .06
- .002

What decimal number is illustrated?





- 3.9
- 3.89
- 3.09
- 3.390

Lesson 3

In 96.1, in which place is the 9?

- tenths
- ones
- tens

In 2,056.49, in which place is the 6?

- hundreds
- ones
- hundredths
- thousands

In 85.2, in which place is the 2?

- tenths
- ones
- tens

What decimal number is illustrated?

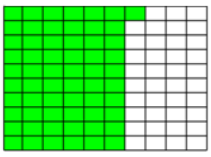

- 6.1
- .61
- 6.01
- 6.001

Lesson 4

What decimal number is illustrated?

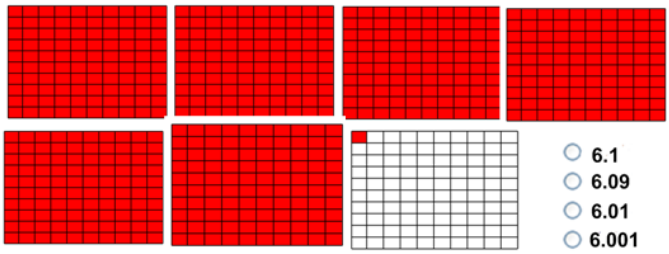

- 6.1
- 6.09
- 6.01
- 6.001