KMD2 Worksheet video 1 Name _____

1. Compare the objects. Draw a blue circle around the object that is longer. Then guess how many cubes long the longer object is. Use the green cube to check. Is your answer close? Write the actual number above the check line.

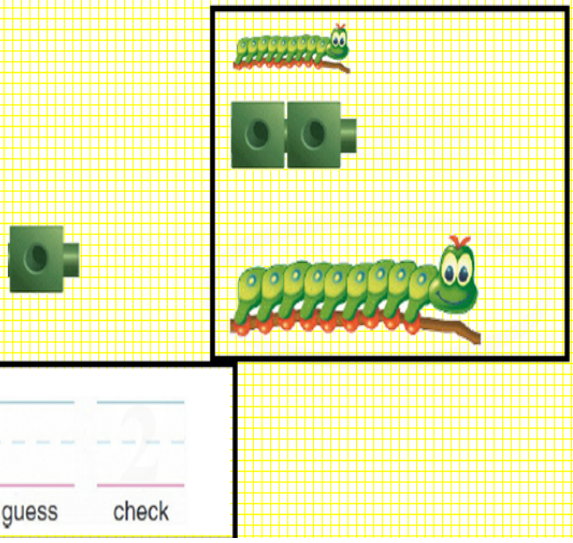

guess check

2. Compare the objects. Draw a red circle around the object that is longer. Then guess how many pennies long the longer object is. Is your answer close? Write the actual number on the guess line.

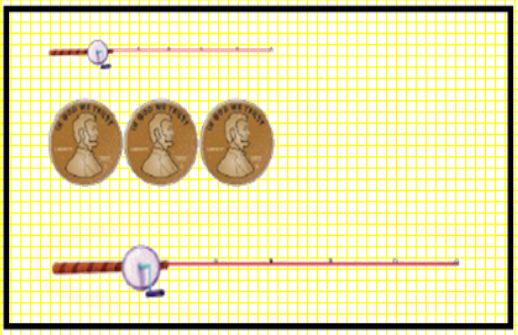

guess check

3. Compare the objects. Draw a green circle around the object that is longer. Then guess how many cubes long the longer object is. Is your answer close? Write the actual number on guess line.

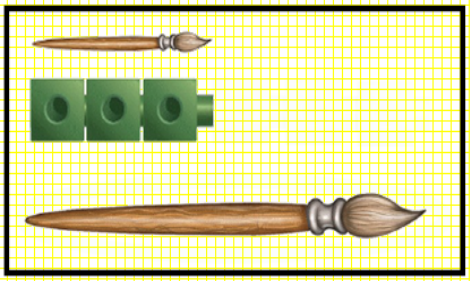

guess check

4. Compare the objects. Draw a black circle around the object that is longer. Then guess how many cubes long the longer object is. Use the green cube to check. Is your answer close? Write the actual number above the guess line.

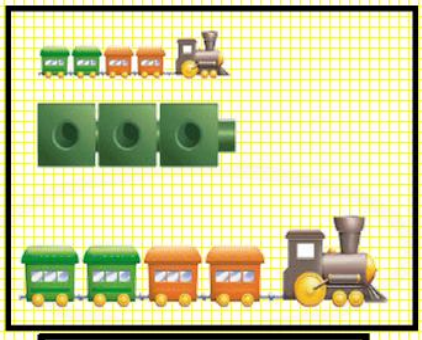

guess check