Worksheet for Exit from K to 1st grade Video – 2 Name _____

Look at the first object. Find the matching shape and fill in the circle below the object. Prob. 1

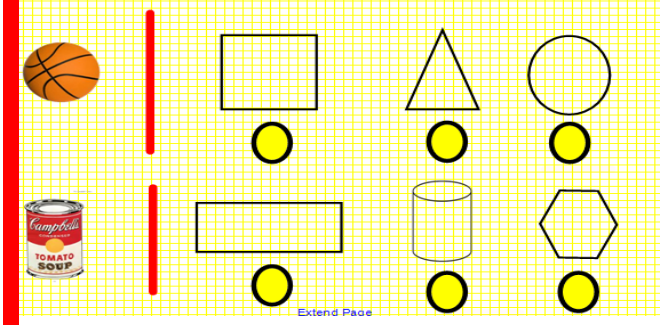

Count the number of objects for A and B then fill in the correct answer. Problem 2

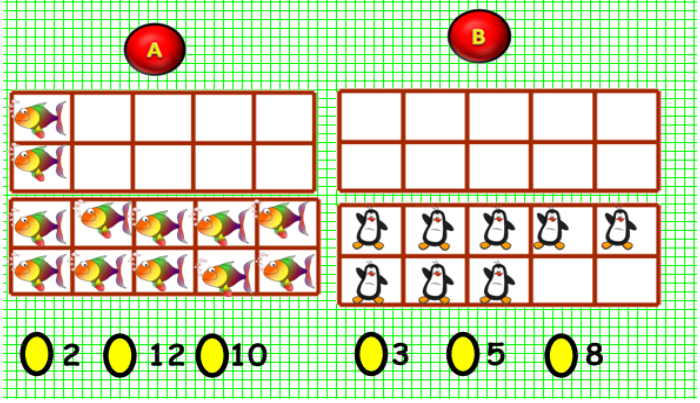

Read the question below and fill in the correct answer for A or B Problem 3

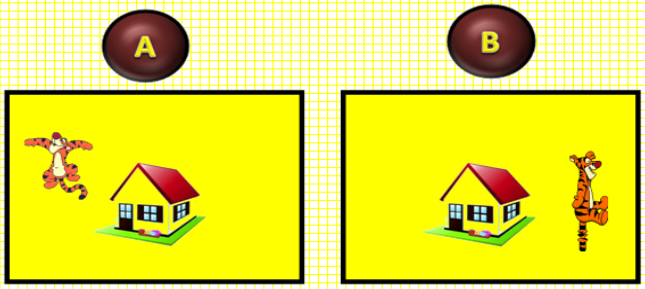

Which picture shows Tigger on the Left side of the house?

Which picture shows Tigger on the right side of the house?

Read the question below and fill in the correct answer for A or B Problem 4

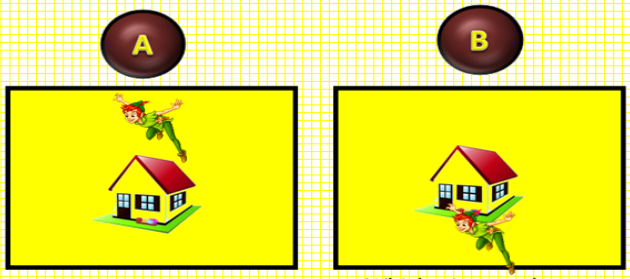

Which picture shows Peter Pan below the house?

Which picture shows Peter Pan above the house?

Count the fish and then write in the answer in the space listed below and then darken in the correct answer. Prob. 5

_____ + _____ = _____

4 8 7 10

Fill in the answer below that makes the subtraction story true. Problem 6

10 — 4 = _____

4 6 5